Name _____ Date _____

Count Back

within 20

Hop back on the line. Write the answer.

1. **15 − 2 =** ☐

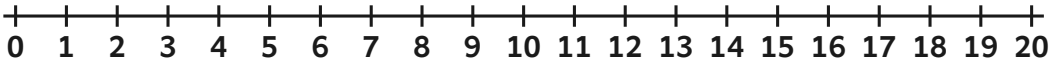

2. **7 − 2 =** ☐

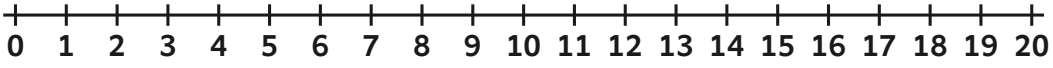

3. **10 − 4 =** ☐

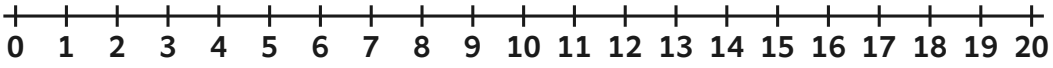

4. **14 − 3 =** ☐

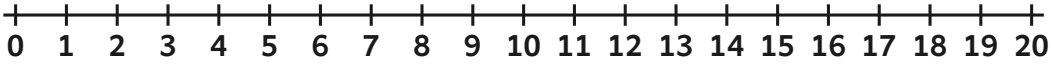

5. **15 − 1 =** ☐

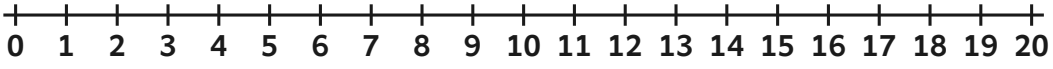

6. **13 − 3 =** ☐

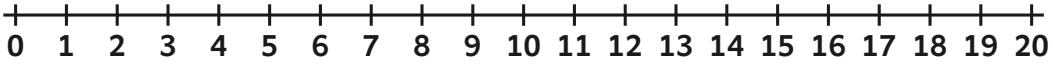

Answer key

Count Back

within 20

Hop back on the line. Write the answer.

1. $15 - 2 = \boxed{13}$

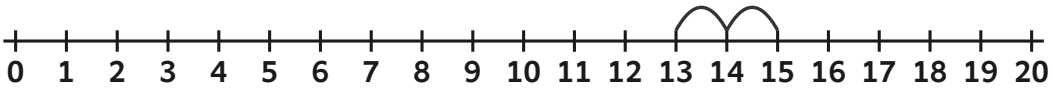

2. $7 - 2 = \boxed{5}$

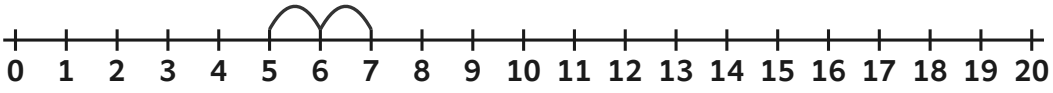

3. $10 - 4 = \boxed{6}$

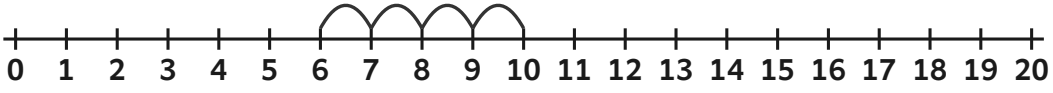

4. $14 - 3 = \boxed{11}$

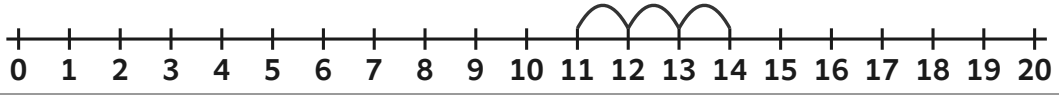

5. $15 - 1 = \boxed{14}$

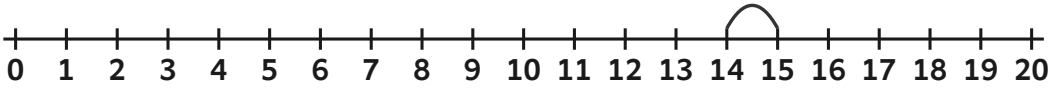

6. $13 - 3 = \boxed{10}$

