Name _____ Date _____

Count Back

within 20

Hop back on the line. Write the answer.

1. **19 − 5 =** ☐

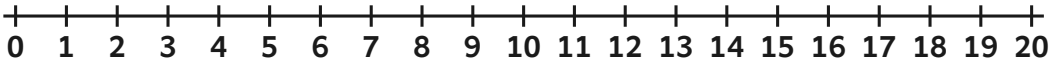

2. **15 − 4 =** ☐

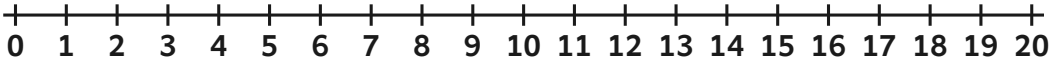

3. **15 − 5 =** ☐

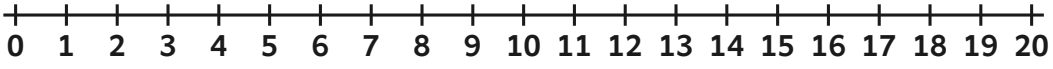

4. **18 − 5 =** ☐

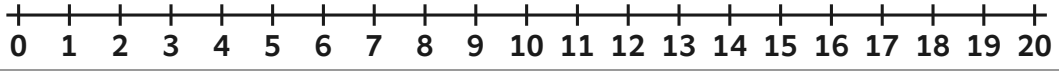

5. **17 − 2 =** ☐

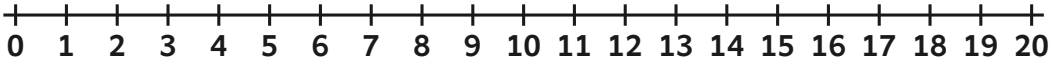

6. **13 − 1 =** ☐

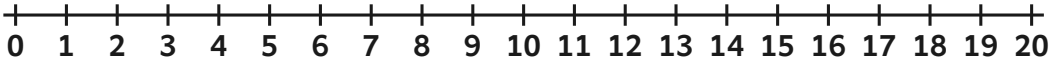

Answer key

Count Back

within 20

Hop back on the line. Write the answer.

1. $19 - 5 = \boxed{14}$

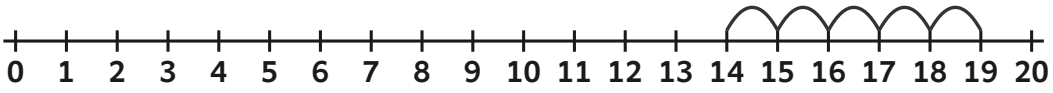

2. $15 - 4 = \boxed{11}$

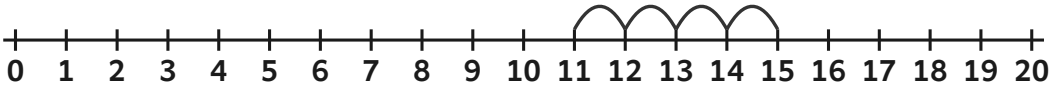

3. $15 - 5 = \boxed{10}$

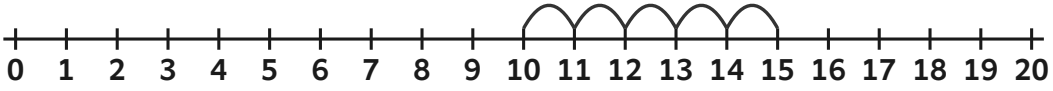

4. $18 - 5 = \boxed{13}$

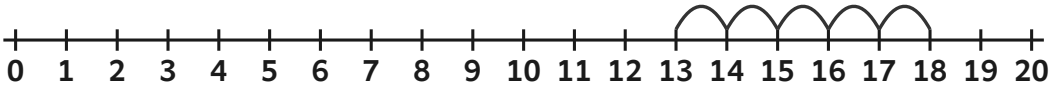

5. $17 - 2 = \boxed{15}$

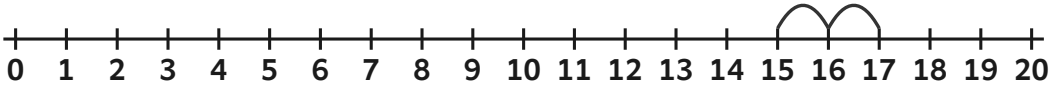

6. $13 - 1 = \boxed{12}$

