Name _____ Date _____

Tell the Time

to the hour

Draw the hands to show the time.



1:00



2:00



5:00



9:00



11:00



12:00

Answer key

Tell the Time

to the hour

Draw the hands to show the time.



1:00



2:00



5:00

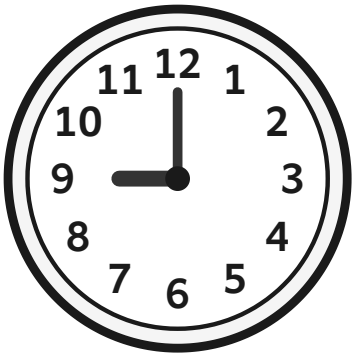

9:00



11:00



12:00