Name _____ Date _____

Count the Blocks

tens

Count the blocks. Write the number.

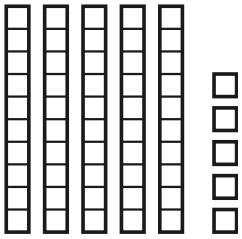

☐ **tens** ☐ **ones =** ☐

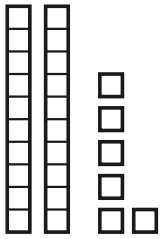

☐ **tens** ☐ **ones =** ☐

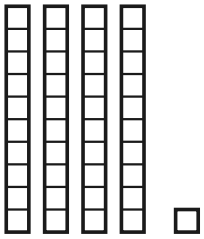

☐ **tens** ☐ **ones =** ☐

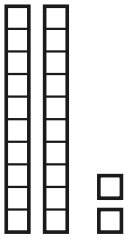

☐ **tens** ☐ **ones =** ☐

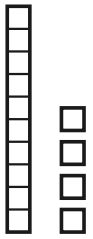

☐ **tens** ☐ **ones =** ☐

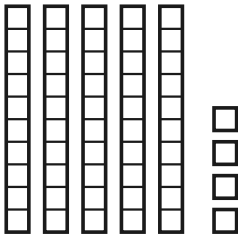

☐ **tens** ☐ **ones =** ☐

Answer key

Count the Blocks

tens

Count the blocks. Write the number.

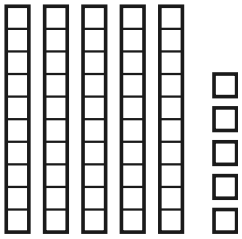

5 tens 5 ones = 55

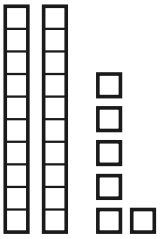

2 tens 6 ones = 26

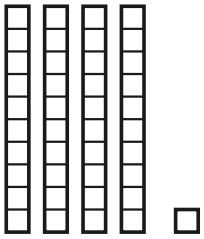

4 tens 1 ones = 41

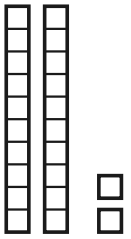

2 tens 2 ones = 22

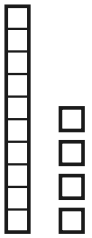

1 tens 4 ones = 14

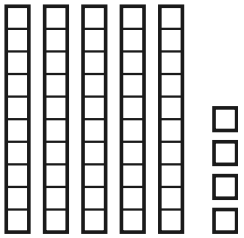

5 tens 4 ones = 54