Name _____ Date _____

Count the Blocks

tens

Count the blocks. Write the number.

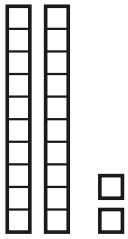

☐ **tens** ☐ **ones =** ☐

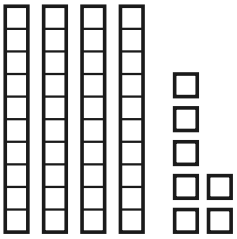

☐ **tens** ☐ **ones =** ☐

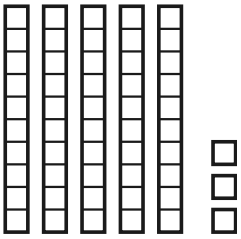

☐ **tens** ☐ **ones =** ☐

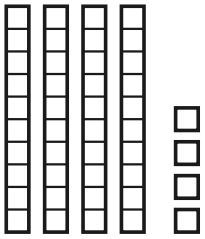

☐ **tens** ☐ **ones =** ☐

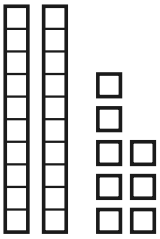

☐ **tens** ☐ **ones =** ☐

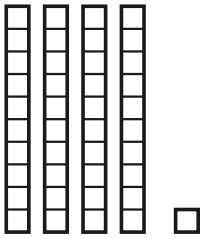

☐ **tens** ☐ **ones =** ☐

Answer key

Count the Blocks

tens

Count the blocks. Write the number.

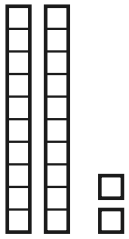

2 tens 2 ones = 22

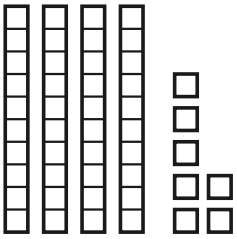

4 tens 7 ones = 47

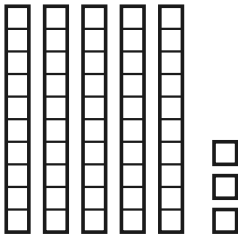

5 tens 3 ones = 53

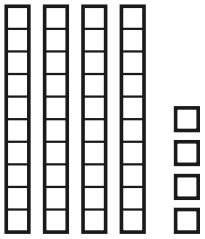

4 tens 4 ones = 44

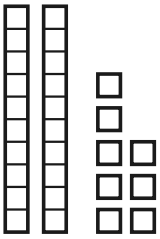

2 tens 8 ones = 28

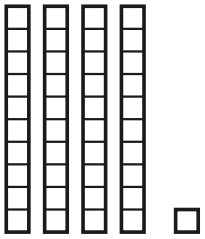

4 tens 1 ones = 41